Name_____ Date_____

Determine the slope of each line by filling in the blanks. Select the answer from the multiple choice answers.

1. A. B. C. D.

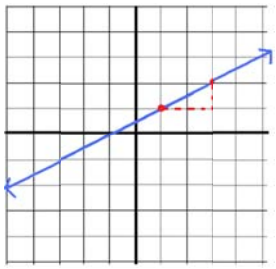

2. A. B. C. D.

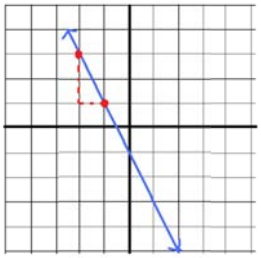

3. A. B. C. D.

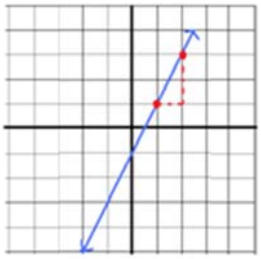

4. A. B. C. D.

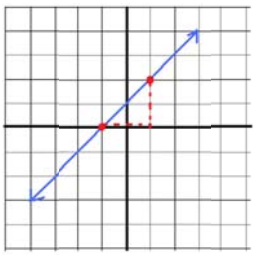
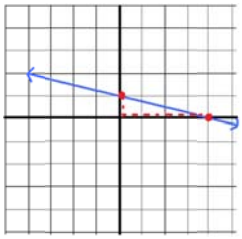
5. A. B. C. D.